Geometry (G.CO.2, 5)
Unit One A – Rotations – Day 2 (HW12)

Name: _____
Date: _____ Period: _____

1. $R_{O,\,90^\circ CCW}$ (ΔABC)

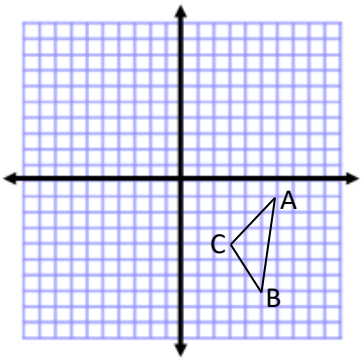

2. $R_{O,\,270^\circ CCW}$ (ΔABC)

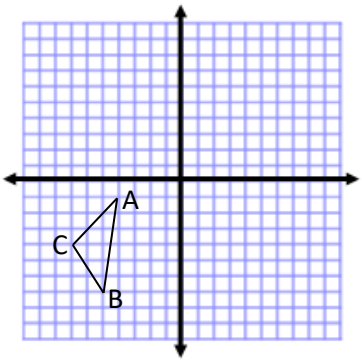

3. $R_{O,\,180^\circ CCW}$ (ΔABC)

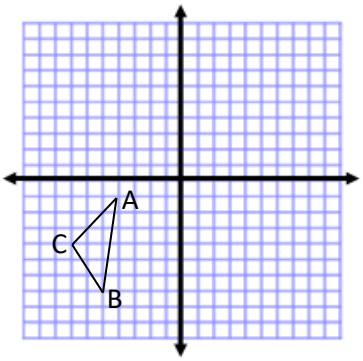

4. $R_{O,\,90^\circ CW}$ (ΔABC)

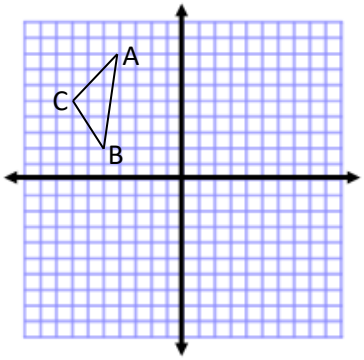

Review Plane Rotations:

1. $R_{A,\,150^\circ CCW}$ $(\overline{BC})$

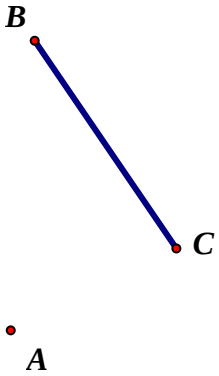
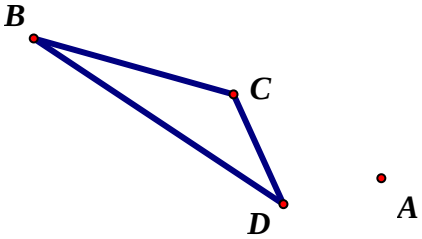
2. $R_{A,\,80^\circ CW}$ (ΔBCD)